Maths Key Skills Stage 4: Skill Check 5

Name: _____ **Date:** _____ **Class/Group:** _____

A: Place Value, Add and Subtract		B: Multiply, Divide and Fractions		C: Measure, Geometry and Statistics	
1. What is the missing number? 1,000 ☐ 3,000 4,000 5,000	*4:1*	11. 6 x 9 =	*4:9*	21. Tim and Sue both weighed themselves. Tim's weight was 31.5 kg. Sue's weight was 3200g. How many grams heavier was Sue?	*4:19*
2. What is the missing number? 200 225 250 ☐ 300	*4:1*	12. Complete the sum that is equal to 6 x 7 x 12: ☐ x 12	*4:10*		
3. Round this number to the nearest 1,000: 2,167	*4:2*	13. 236 x 8 =	*4:11*	22. Tick (✓) the shape that has exactly one line of symmetry. 	*4:25*
4. What is 1,000 **more** than 960?	*4:2*	14. To work out 39 x 8 you could do: 30 x ☐ + ☐ x 8	*4:12*		
5. If the temperature starts at 3°C, then drops by 9°C, what is it now?	*4:3*	15. $\frac{15}{40} = \frac{3}{?}$	*4:13*	23. Complete this shape: 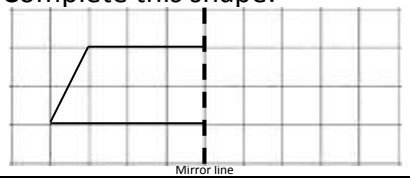	*4:26*
6. What is the value of the **8** in this number? 2,789	*4:4*	16. What is the missing number? 2.96 2.97 2.98 2.99 ☐	*4:14*		
7. Write the number 13 in Roman numerals.	*4:5*	17. $\frac{11}{15} + \frac{4}{15}$	*4:15*	24. Favourite meats of Lower School: 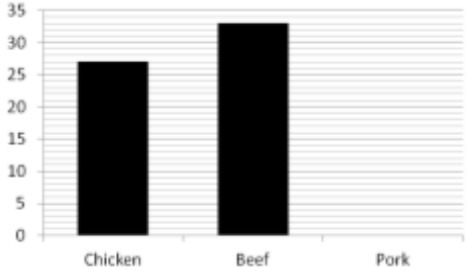 17 pupils said pork. Show this.	*4:29*
8. 8,629 - 5,318 =	*4:6*	18. Write $\frac{3}{4}$ as a decimal number.	*4:16*		
9. **Estimate** the answer to: 4,012 + 15,982	*4:7*	19. 23 ÷ 10 =	*4:17*		
10. From 500 tickets, pupils buy 235 & parents buy 188. How many are left?	*4:8*	20. Using £10, Rob buys a drink for 90p and a wrap for £2.50. How much left?	*4:18*	25. How many pupils are there in Lower School?	*4:30*
Total (A)		Total (B)		Total (C)	
Test Total (A+B+C)		R (0-9)	Y (10-19)	G (20-25)	

Maths Key Skills Stage 4: Skill Check 5 **Answers**

Name: _____ **Date:** _____ **Class/Group:** _____

A: Place Value, Add and Subtract		B: Multiply, Divide and Fractions		C: Measure, Geometry and Statistics	
1. What is the missing number? 1,000 [ ] 3,000 4,000 5,000	*4:1* **2,000**	11. 6 x 9 =	*4:9* **54**	21. Tim and Sue both weighed themselves. Tim's weight was 31.5 kg. Sue's weight was 3200g. How many grams heavier was Sue?	*4:19* **500**
2. What is the missing number? 200 225 250 [ ] 300	*4:1* **275**	12. Complete the sum that is equal to 6 x 7 x 12: [ ] x 12	*4:10* **42**		
3. Round this number to the nearest 1,000: 2,167	*4:2* **2,000**	13. 236 x 8 =	*4:11* **1,888**	22. Tick (✓) the shape that has exactly one line of symmetry.	*4:25* **Triangle ticked**
4. What is 1,000 **more** than 960?	*4:2* **1,960**	14. To work out 39 x 8 you could do: 30 x [ ] + [ ] x 8	*4:12* **8, 9**		
5. If the temperature starts at 3°C, then drops by 9°C, what is it now?	*4:3* **-6°C**	15. $\frac{15}{40} = \frac{3}{?}$	*4:13* **8**	23. Complete this shape: 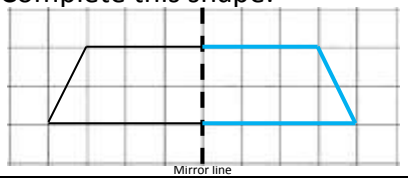	*4:26* **Shape drawn**
6. What is the value of the **8** in this number? 2,789	*4:4* **80**	16. What is the missing number? 2.96 2.97 2.98 2.99 [ ]	*4:14* **3(.00)**		
7. Write the number 13 in Roman numerals.	*4:5* **XIII**	17. $\frac{11}{15} + \frac{4}{15}$	*4:15* $\frac{15}{15}$ **or 1**	24. Favourite meats of Lower School: 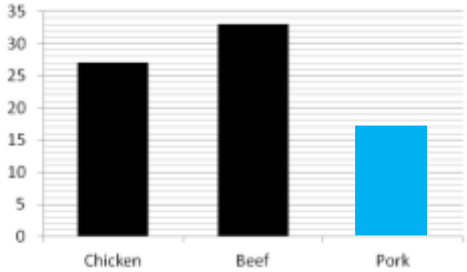 17 pupils said pork. Show this.	*4:29* **Bar drawn**
8. 8,629 - 5,318 =	*4:6* **3,311**	18. Write $\frac{3}{4}$ as a decimal number.	*4:16* **0.75**		
9. **Estimate** the answer to: 4,012 + 15,982	*4:7* **20,000**	19. 23 ÷ 10 =	*4:17* **2.3**		
10. From 500 tickets, pupils buy 235 & parents buy 188. How many are left?	*4:8* **77**	20. Using £10, Rob buys a drink for 90p and a wrap for £2.50. How much left?	*4:18* **£6.60**	25. How many pupils are there in Lower School?	*4:30* **77**
Total (A)		Total (B)		Total (C)	
Test Total (A+B+C)		R (0-9)	Y (10-19)	G (20-25)	